Year 3 Maths Activity Mat

Section 1

Draw an arrow pointing to 8kg 500g.

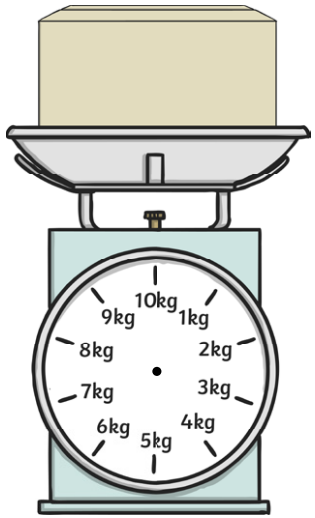

Section 2

Complete this calculation:

$$\begin{array}{r} 1\ 5\ 6 \\ \times\quad\ 2 \\ \hline \\ \hline \end{array}$$

Section 3

A school has 6 classes. There are 28 children in each class. How many children are there in the school altogether?

Section 4

What fraction is **not** coloured in?

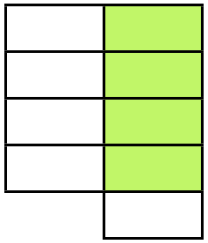

Section 5

Measure this with your ruler. How many mm long is it?



Section 6

100 + 74 + 100 =

Section 7

Multiply the two bottom numbers to find the missing number.

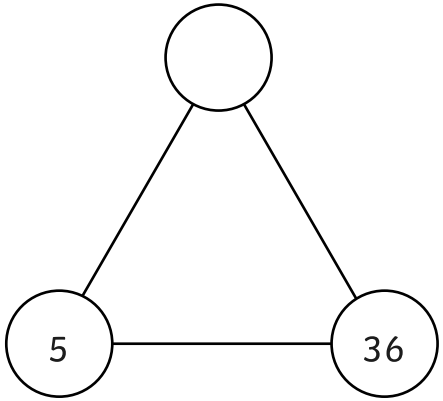

Section 8

Start at 1578.

Count on 5.

What is your answer?

Year 3 Maths Activity Mat: 3

Answers

Section 1

Draw an arrow pointing to 8kg 500g.

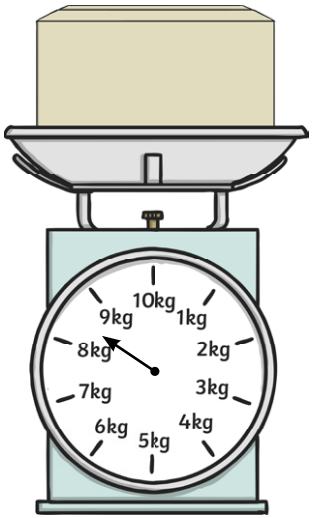

Section 2

Complete this calculation:

	1	5	6
x			2
	3	**1**	**2**

Section 3

A school has 6 classes. There are 28 children in each class. How many children are there in the school altogether?

168

Section 4

What fraction is **not** coloured in?

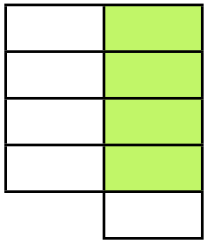

$\frac{5}{9}$

Section 5

Measure this with your ruler. How many mm long is it?



46mm

Section 6

100 + 74 + 100 = **274**

Section 7

Multiply the two bottom numbers to find the missing number.

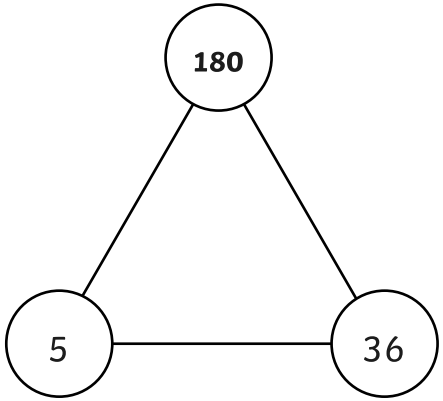

Section 8

Start at 1578.

Count on 5.

What is your answer? **1583**